Bar Graph

Name:_____ Date:_____

The students in the school wrote their most favorite color. Each color is equal to 200 colors.

students favorite colors	
Orange	Yellow
Blue	Green
Orange	Green
Blue	
Orange	
Blue	
Blue	

Write the Count in the chart.

Orange	Yellow	Blue	Green

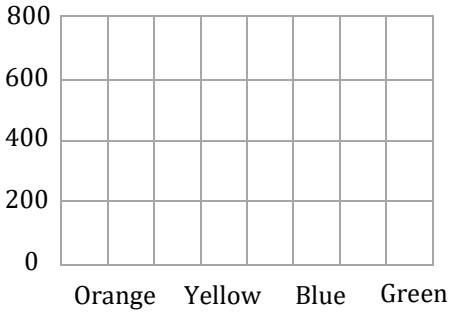

1) Did more students like yellow or orange?

_____

2) Did fewer students like orange or green?

_____

3) Which is the least favorite color?

_____

4) Which one is the most favorite color?

_____

The list below shows the different food items students brought for the lunch. Each box is equal to 300 boxes.

students favorite food	
Donut	Tofu
Pizza	Pasta
Donut	Tofu
Pizza	
Donut	
Pizza	
Donut	

Write the Count in the chart.

Donut	Pizza	Tofu	Pasta

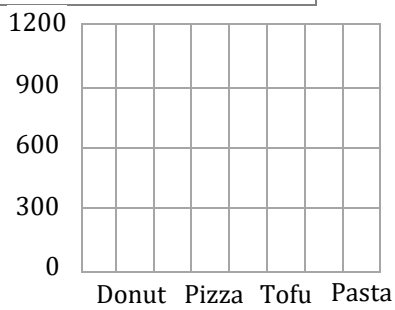

1) Which is the least item the student brought?

_____

2) How much pizzas are there in the party?

_____

3) How many boxes of pasta are there?

_____

4) Which items did the most students brought?

_____

Bar Graph

Name:_____ Date:_____

The students in the school wrote their most favorite color. Each color is equal to 200 colors.

students favorite colors	
Orange	Yellow
Blue	Green
Orange	Green
Blue	
Orange	
Blue	
Blue	

Write the Count in the chart.

Orange	Yellow	Blue	Green
3 x 200	1 x 200	4 x 200	2 x 200

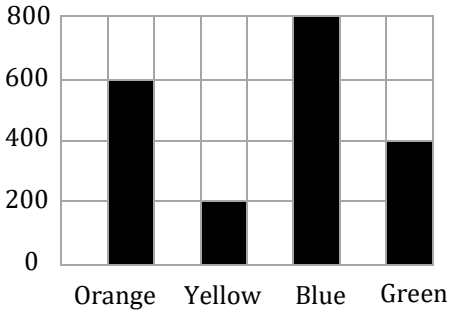

1) Did more students like yellow or orange?

Orange

2) Did fewer students like orange or green?

Green

3) Which is the least favorite color?

Yellow

4) Which one is the most favorite color?

Blue

The list below shows the different food items students brought for the lunch. Each box is equal to 300 boxes.

students favorite food	
Donut	Tofu
Pizza	Pasta
Donut	Tofu
Pizza	
Donut	
Pizza	
Donut	

Write the Count in the chart.

Donut	Pizza	Tofu	Pasta
4 x 300	3 x 300	2 x 300	1 x 300

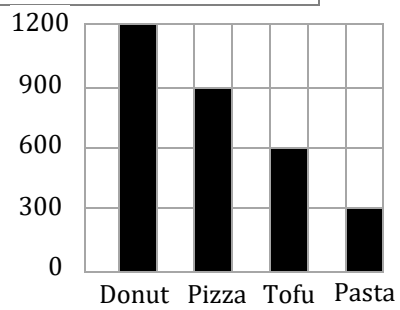

1) Which is the least item the student brought?

Pasta

2) How much pizzas are there in the party?

900

3) How many boxes of pasta are there?

300

4) Which items did the most students brought?

Donuts