Tally Chart – Bakery Items

Name:_____ Date:_____

Cut out each bakery item and paste it on the graph above the same kind. Based on the graph, make tally chart and answer the questions.

5						
4						
3						
2						
1						
0						

1) How many are there? _____

2) How many more than ? _____

3) How many are there? _____

4) Which has the most?

5) How many are there? _____



Tally Chart – Bakery Items

Name:_____ Date:_____

Cut out each bakery item and paste it on the graph above the same kind. Based on the graph, make tally chart and answer the questions.

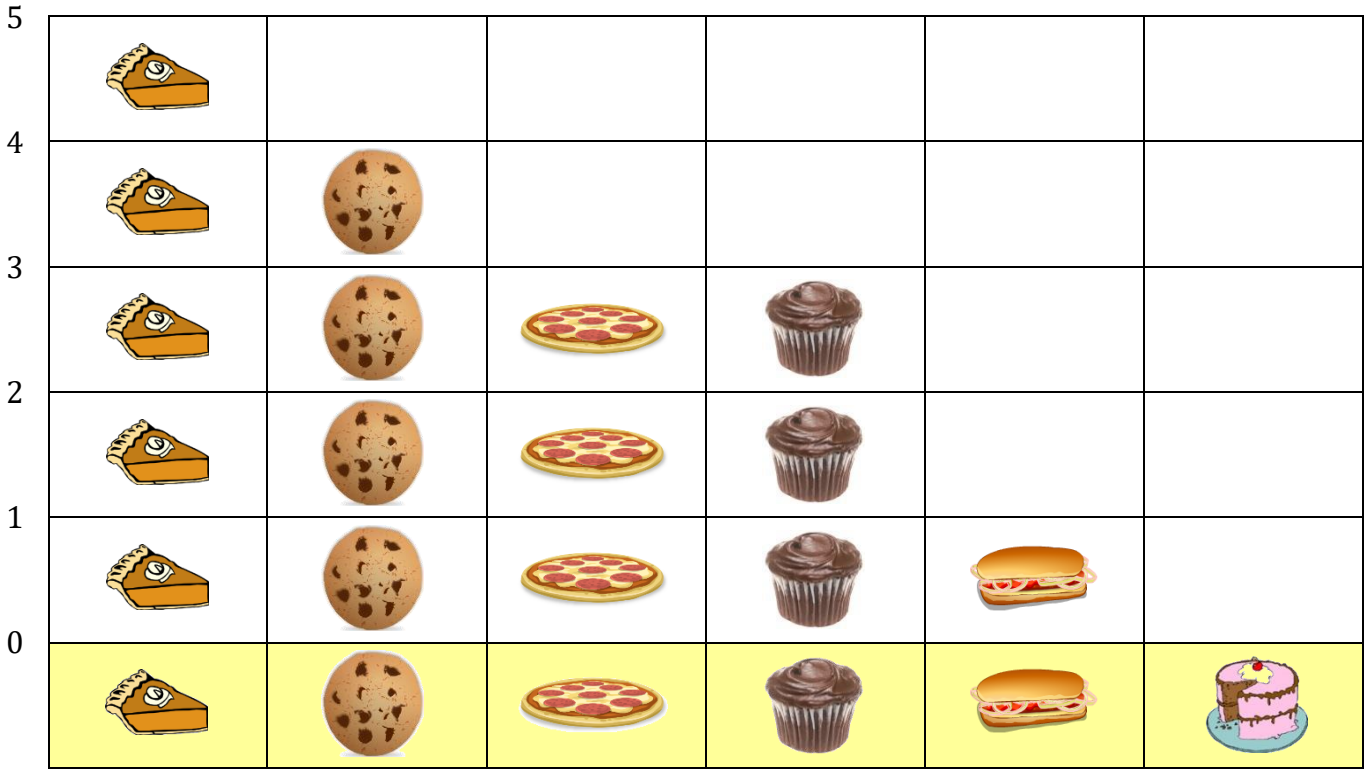



1) How many are there? 3

2) How many more than ? 2

3) How many are there? 4

4) Which has the most? 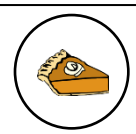

5) How many are there? Zero